Telling the time

1) Show me ten **past** 2 on the analogue and digital clock.

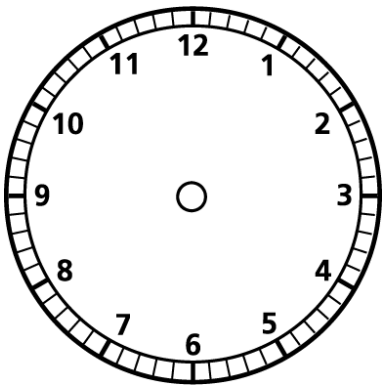

2) Show me twenty **past** 8 on the analogue and digital clock.

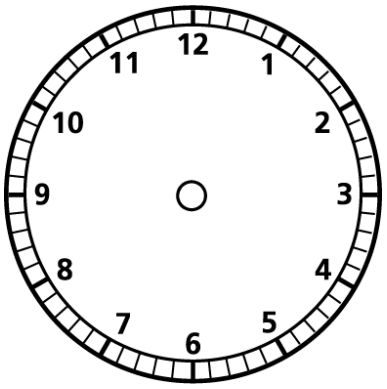

3) Show me ten **to** 5 on the analogue and digital clock.

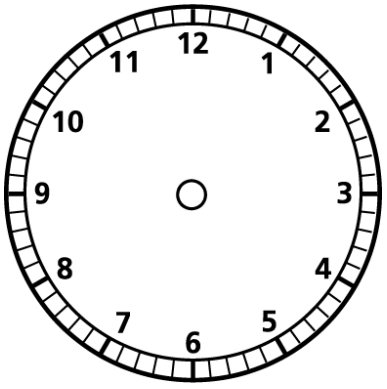

4) Show me twenty five **to** 12 on the analogue and digital clock.

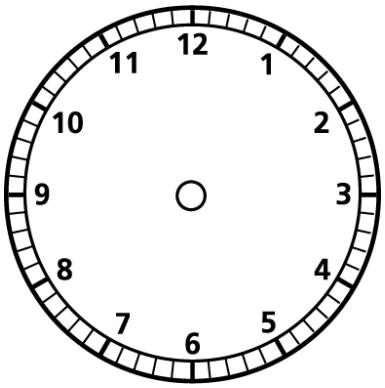

5) Show me five **past** 3 on the analogue and digital clock.

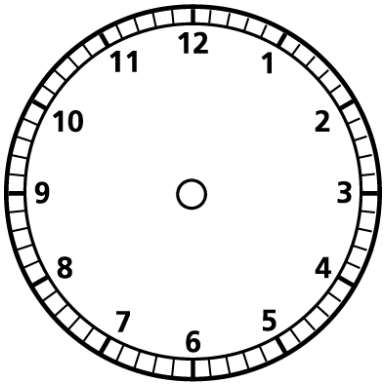
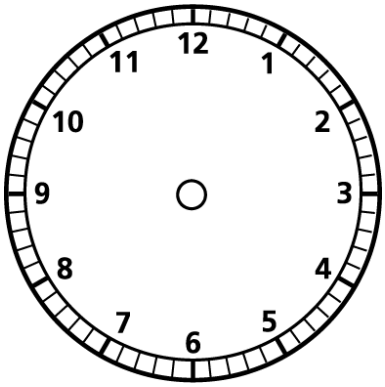
6)Show me five **to** 9 on the analogue and digital clock.